Math worksheet on *'Base 10 Blocks - Counting - Picture to Number - Tens and Ones (Level 2)'*. Part of a broader unit on *'Number Sense - Basics'*

Learn online: app.mobius.academy/math/units/number_sense_basics/

1 Find the total number of blocks

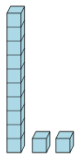

a	b	c
4252	32	4553
d	**e**	**f**
12	20	52

2 Find the total number of blocks

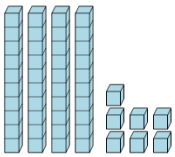

a	b	c
64	59	17
d	**e**	**f**
10	2020	47

3 Find the total number of blocks

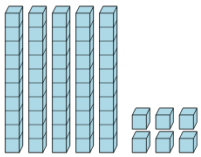

a	b	c
85	69	86
d	**e**	**f**
56	481	3490

4 Find the total number of blocks

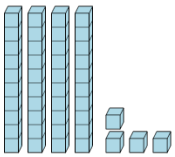

a	b	c
44	61	65
d	**e**	**f**
113	3	66

5 Find the total number of blocks

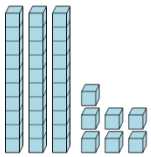

a	b	c
11	5048	10
d	**e**	**f**
9	25	37

6 Find the total number of blocks

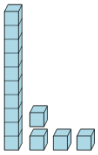

a	b	c
14	36	4001
d	**e**	**f**
1423	0	47

7 Find the total number of blocks

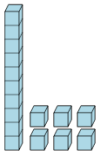

a	b	c
25	32	508
d	**e**	**f**
16	146	5